Describe position

1 Here is a map of part of a town.

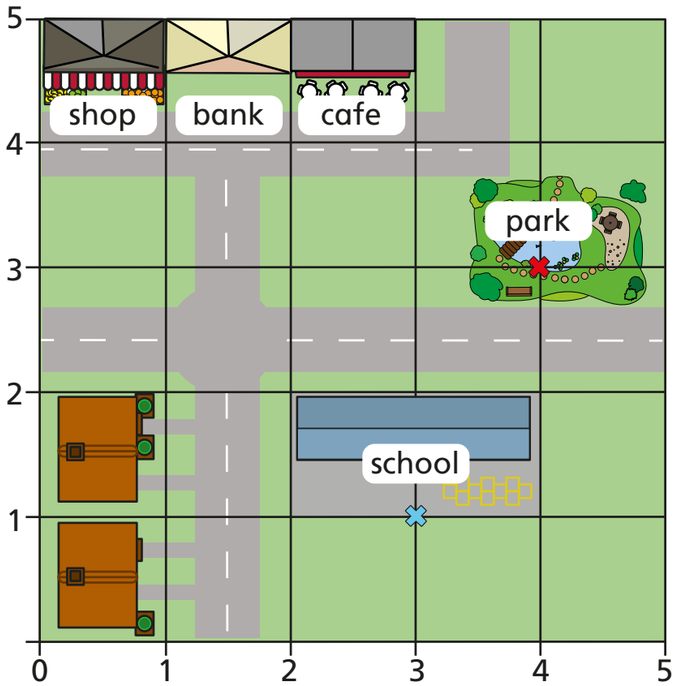

a) Which place is next to the shop? _____

b) Which place is next to the bank and close to the park? _____

c) The front gates of the school have been marked with a cross.

Write the coordinates of the school gates. (☐ , ☐)

d) The slide in the park has been marked with a cross.

Write the coordinates of the slide. (☐ , ☐)

Compare answers with a partner.

2 A map of the world is drawn on a grid.

Some locations are marked at points A to E.

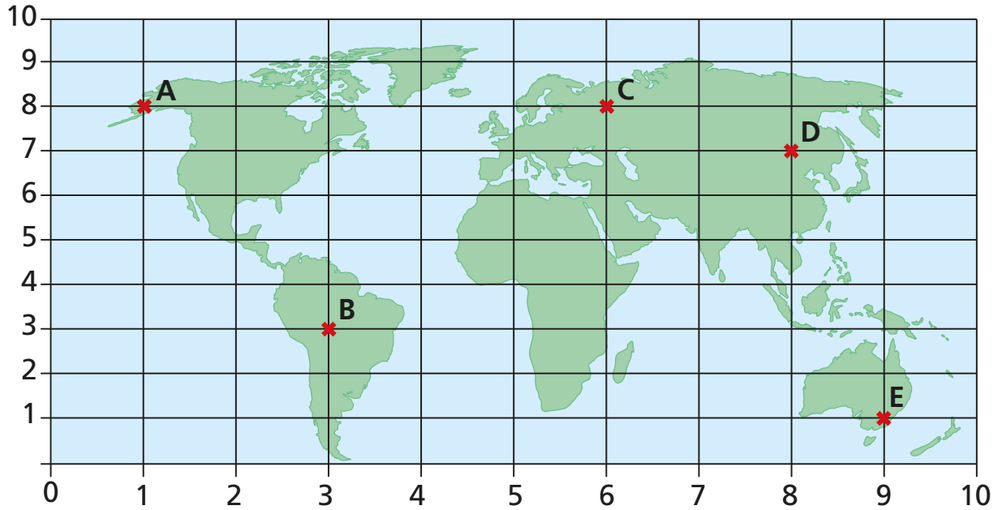

a) Which point is at the bottom right of the grid?

_____

b) Which two points are to the left of point C on the map?

_____ and _____

c) Write the coordinates of each location.

A (☐ , ☐) D (☐ , ☐)

B (☐ , ☐) E (☐ , ☐)

C (☐ , ☐)

© White Rose Maths 2020

3 Some shapes are drawn on a grid.

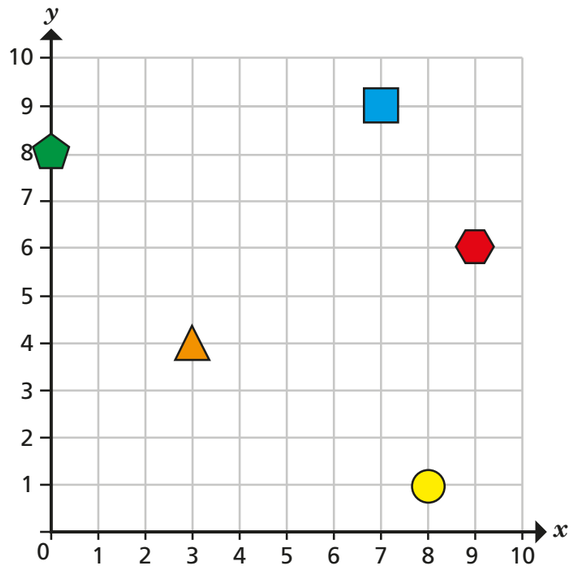

a) Tommy, Dora and Eva are working out the coordinates of the pentagon.

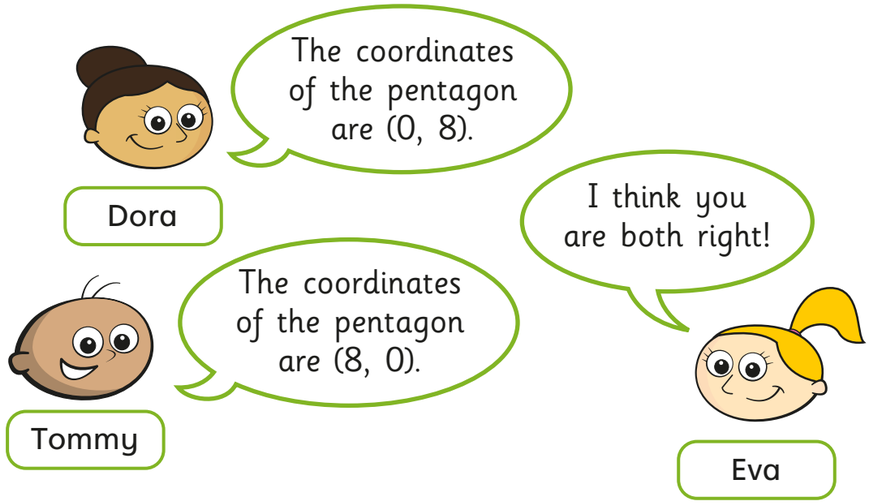

Who is correct? _____

Talk about it with a partner.

b) Write the coordinates of the other shapes.

square (☐ , ☐) triangle (☐ , ☐)

circle (☐ , ☐) hexagon (☐ , ☐)

4 Six points are drawn on a grid.

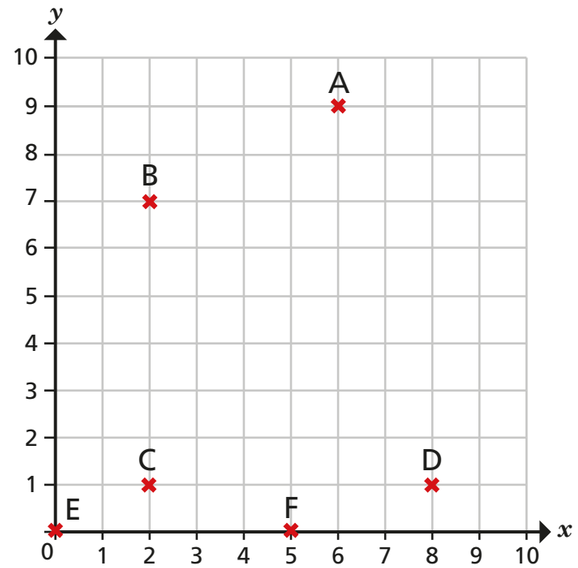

a) Write the coordinates of each point.

A (☐ , ☐) C (☐ , ☐) E (☐ , ☐)

B (☐ , ☐) D (☐ , ☐) F (☐ , ☐)

b) Teddy and Alex each choose a point.

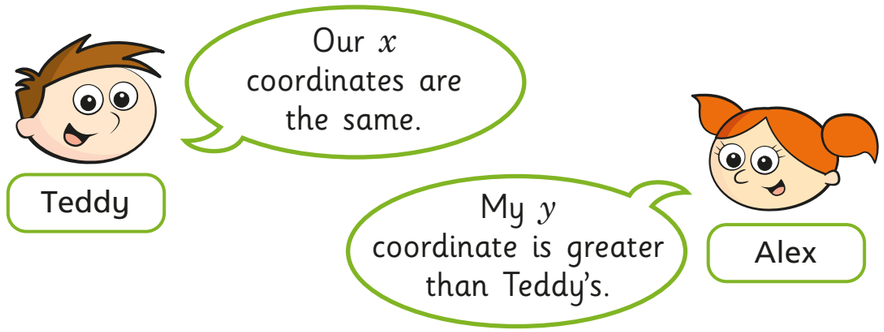

What points have Alex and Teddy chosen?

Alex (☐ , ☐) Teddy (☐ , ☐)

© White Rose Maths 2020